NOME:

MATEMÁTICA

CONTE E ESCREVA O NÚMERO DE ELEMENTOS E DEPOIS O NOME DO NÚMERO, COMO NO EXEMPLO DADO.



	10	DEZ

NOME:_____DATA:___/___/____

MATEMÁTICA

CONTE QUANTOS ELEMENTOS HÁ EM CADA GRUPO E LIGUE AO NUMERAL.

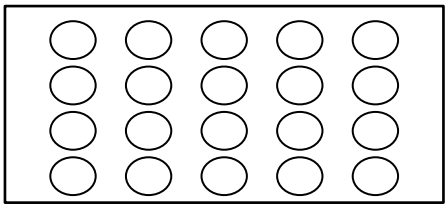

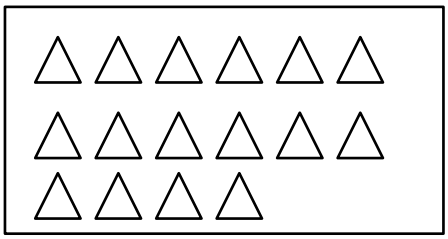







18

20

17

19

16

NOME:_____ DATA:___/___/____

MATEMÁTICA

CONTE QUANTOS ELEMENTOS HÁ EM CADA GRUPO E LIGUE AO NUMERAL.

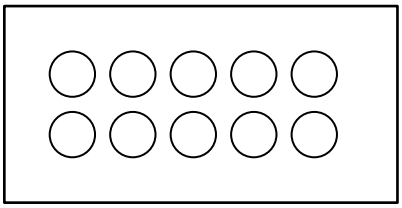

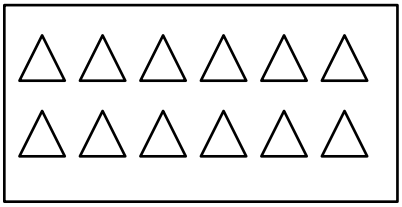



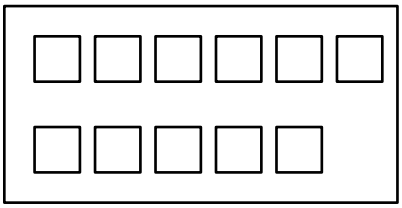





13

10

14

12

15

11

@professora.val

NOME:

LIGUE CADA NUMERAL AO SEU NOME.

9	OITO
2	SEIS
8	ZERO
5	TRÊS
7	DOIS
4	SETE
1	CINCO
3	NOVE
6	UM
0	QUATRO

@professora.val

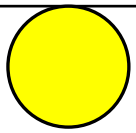		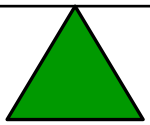	
AMARELO	VERMELHO	VERDE	AZUL

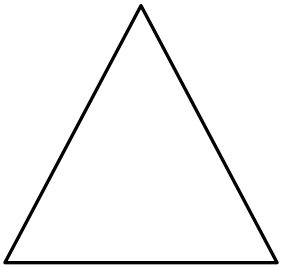







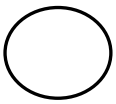



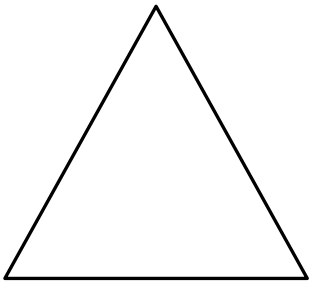











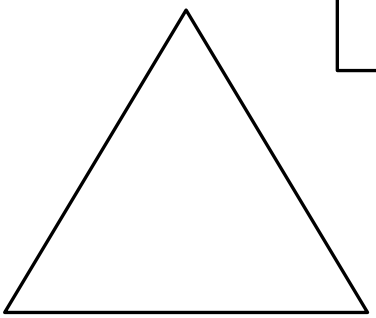



@professora.val

NOME:	DATA: / /
TURMA:	

SEQUÊNCIAS DE FIGURAS

1. OBSERVE CADA SEQUÊNCIA E PINTE AS FIGURAS QUE ESTÃO EM BRANCO.





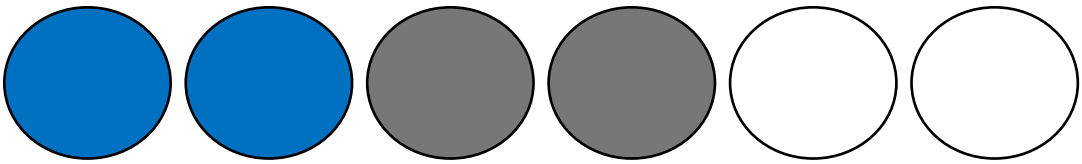

2. AGORA , COMPLETE AS SEQUÊNCIAS DESENHANDO:

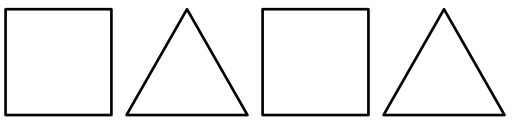

-------- -------- -------- --------

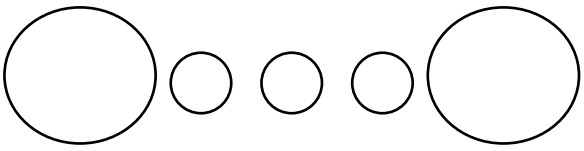

----- ----- -----

@professora.val

NOME: _____

FORMAS GEOMÉTRICAS

VAMOS COLORIR AS FORMAS GEOMÉTRICAS, SEGUINDO AS CORES INDICADAS.



AMARELO



VERMELHO

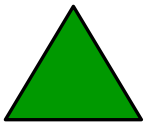

VERDE



AZUL



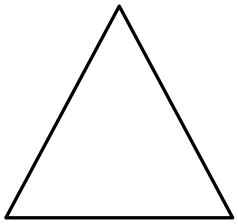



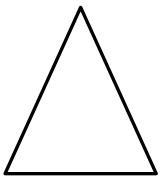















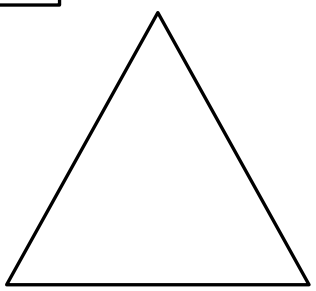



@professora.val

NOME: _____ DATA: / /

MATEMÁTICA

NÚMEROS DE 0 ATÉ 99



VAMOS CONTINUAR A ESCREVER OS NÚMEROS DE 0 ATÉ 99!

0									
									99

@professora.val

NOME: _____ DATA: / /

MATEMÁTICA

NÚMEROS DE 0 ATÉ 99



COMPLETE COM OS NÚMEROS QUE ESTÃO FALTANDO.

0	1		3		5	6		8	9
10		12	13	14		16	17	18	
20	21		23		25		27	28	
30	31	32		34		36		38	39
40		42	43	44		46	47	48	
50	51	52		54		56	57		59
60		62	63		65	66		68	
70	71	72		74	75		77		79
80		82	83	84		86	87		89
90	91	92		94	95	96		98	99

@professora.val

NOME: _____ DATA: __/__/____

MATEMÁTICA

CONTE E ESCREVA O RESULTADO DAS ADIÇÕES ABAIXO.













@professora.val