NOME:

RECORTE E COLE O NÚMERO QUE REPRESENTA A QUANTIDADE.







@professora.val





1

4

2

3

5

NOME:

RECORTE E COLE O NÚMERO QUE REPRESENTA A QUANTIDADE.







@professora.val



9

7

8

6